Section 21 - Interpreting Data, Graphs and Tables

1. Which person spent the most time running and walking combined according to the graph below?

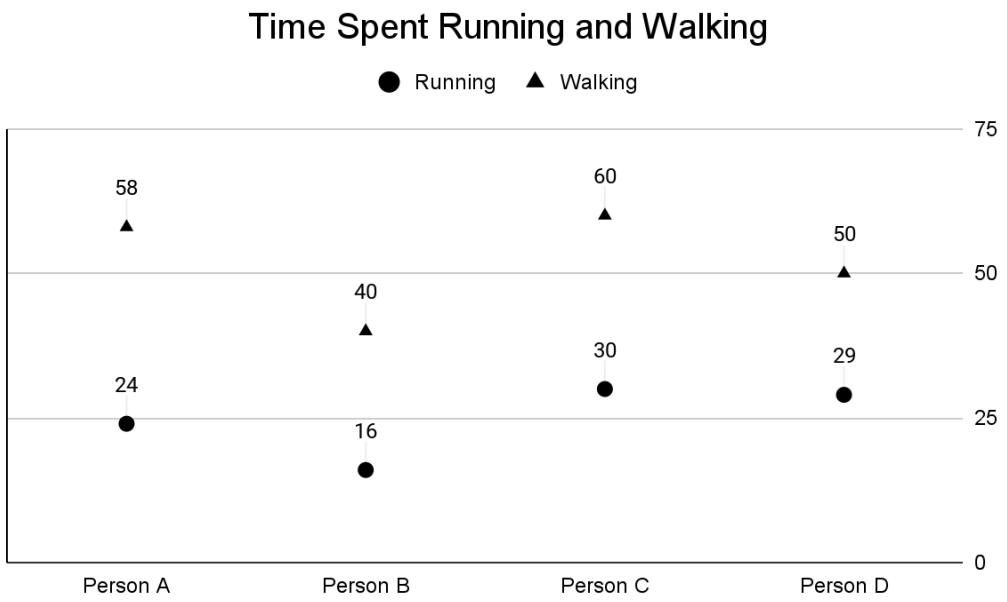

a. Person A
b. Person B
c. Person C
d. Person D

2. In between which years and school was the decrease the most?

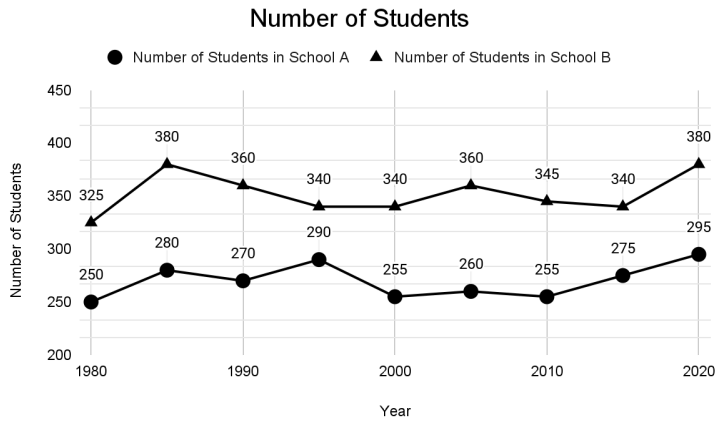

a. School A: 1985 - 1995
b. School A: 1990 - 2000
c. School B: 1985 - 1995
d. School B: 1990 - 2000

SmartThink
Math Education Tech

3. Which of the statements is true based on the following graph?

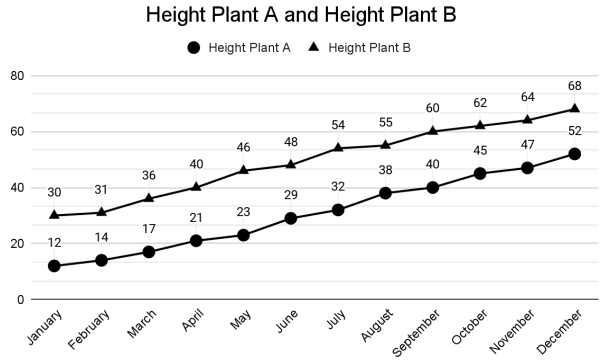

a. Plant A and Plant B both increased at the exact same rate each month
b. Plant A and Plant B both increased but at different rates
c. Plant A increased while Plant B decreased
d. Plant A decreased while Plant B increased

---

4. Which class had the biggest difference in the amount of students in their respective grade?

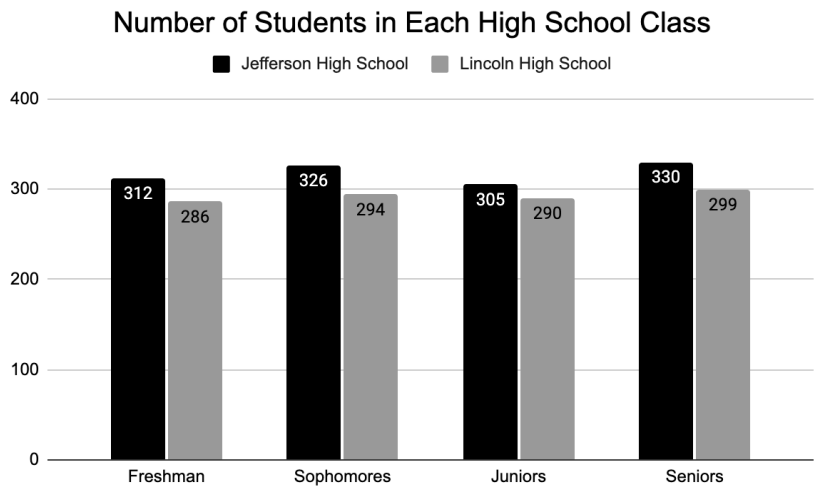

a. Freshman
b. Sophomores
c. Juniors
d. Seniors

SmartThink
Math Education Tech

5. Which candy had the median amount of pieces in the bag?

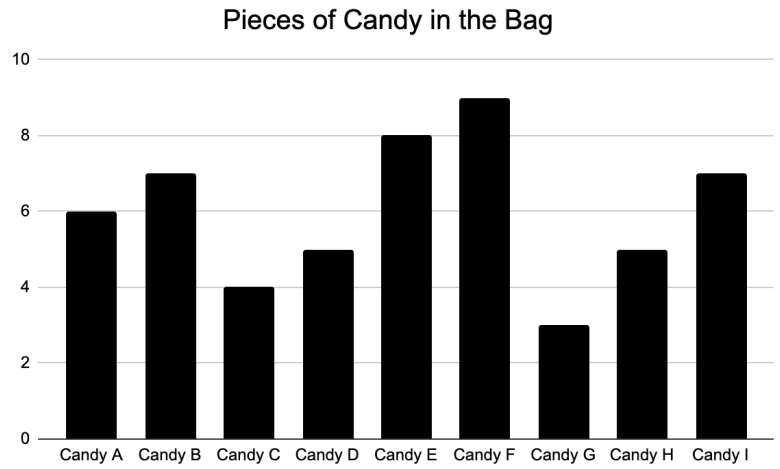

a. Candy A
b. Candy C
c. Candy E
d. Candy H

SmartThink
Math Education Tech

6. What percentage of games were there more than 32 points scored?

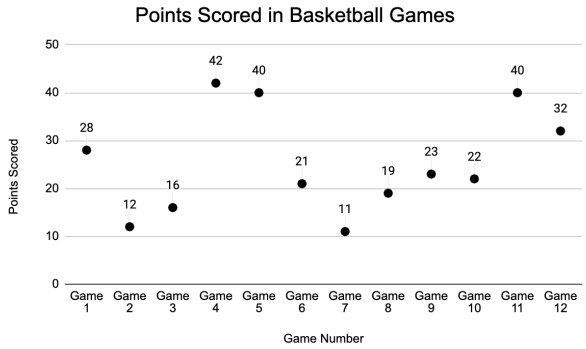

---

7. What is the age difference between the person who studies the most amount of time and the person who studies the least amount of time?

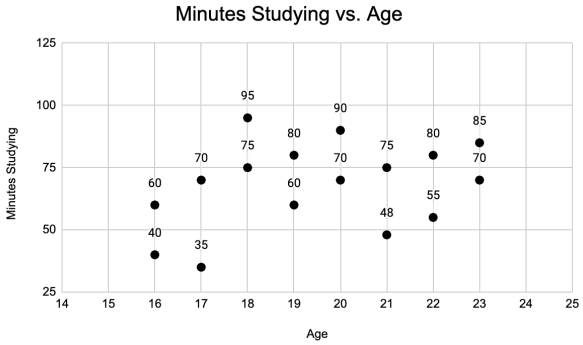

END OF SECTION

ANSWER KEY	
Section 21	
Interpreting Data, Graphs, and Tables	
1. C	5. A
2. C	6. 25
3. B	7. 1
4. B	